Попълни липсващите числа или знаци:

1. $\square - 2 = 10$; $10 - \square = 2$; $\square - 4 = 5$; $5 - \square = 4$

2.

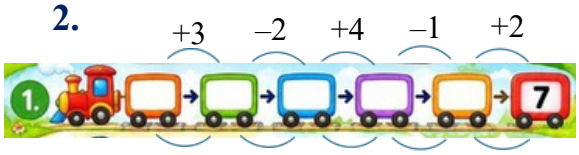

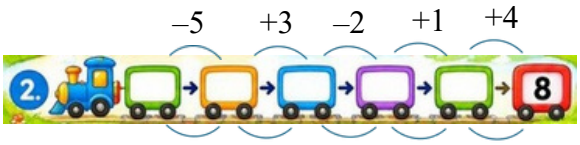

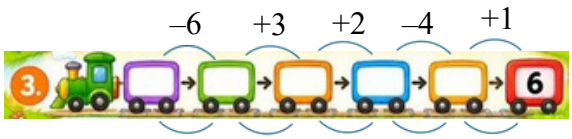

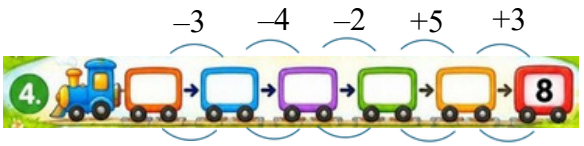

3. <, >, =

 + 3 – 1 ☐ 5 + 1 +

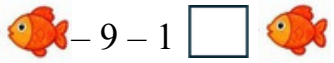 – 9 – 1 ☐ – 8 – 2

4.

$4 + \square - 3 + 5 = 9$ $\square + 5 - 4 + 2 = 8$ $7 - 4 + \square - 6 = 2$

5. Ники имаше 10 евро. Купи си кроасан за 2 евро и сок за 3 евро. После баба му му даде две банкноти по 5 евро. Той си купи книжка за 6 евро. Колко евро му останаха накрая?

/Начертай сам./

6. На детската площадка играят няколко деца. Две деца си тръгнаха, но дойде Мони с братчето си. След това дойде Мая с две приятелки, а три деца си тръгнаха.Така на площадката останаха 5 деца. Колко деца имаше в началото на площадката? Можем ли да кажем веднага?

/Начертай сам./

Отговори:

1. [12] – 2 = 10; 10 – [8] = 2; [9] – 4 = 5; 5 – [1] = 4

2.

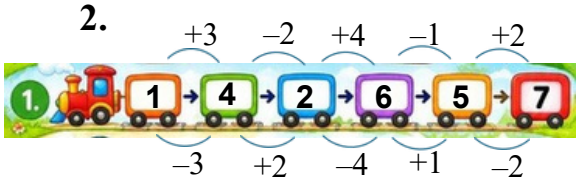

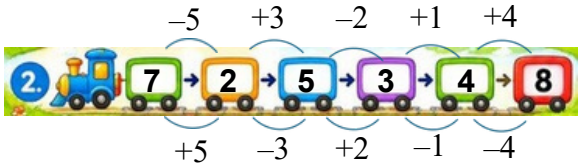

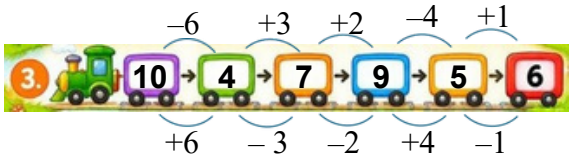

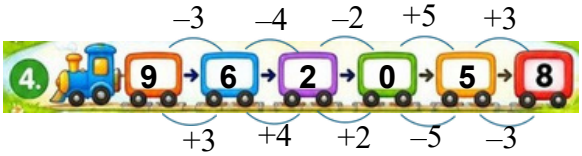

3. <, >, =

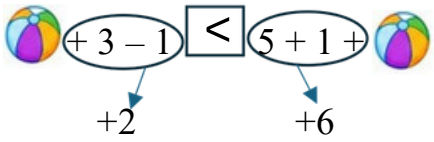



4.

5 + [2] – 3 + 5 = 9 [5] + 5 – 4 + 2 = 8 7 – 4 + [5] – 6 = 2

5.

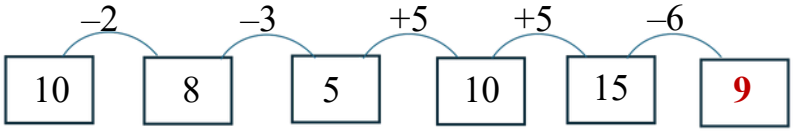

6.

